Lectures 21-23

Chap. 11

Properties of Materials

Classes of Materials:

Solids --- fixed shape can be crystals (simple geometrical shape) or amorphous (glasses, plastics)

Liquids -- can flow, fill shape of container BUT incompressible

Gases --- compressible otherwise like liquids

Solids

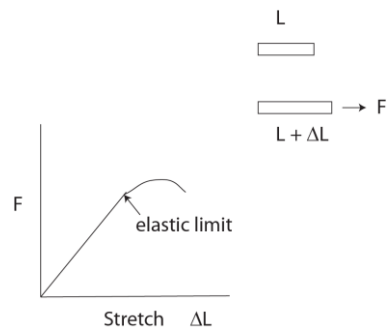

- Can stretch
- ΔL proportional to F up to elastic limit (Hooke's law)

Stress = F/A (N/m2 OR Pascals abrrev. = Pa)

Strain =DL/L

Modulus of Elasticity = Stress/strain

YOUNG's Modulus $Y = \dfrac{F/A}{\Delta L / L}$ typically a high number ~ 100 GPa

BULK Modulus

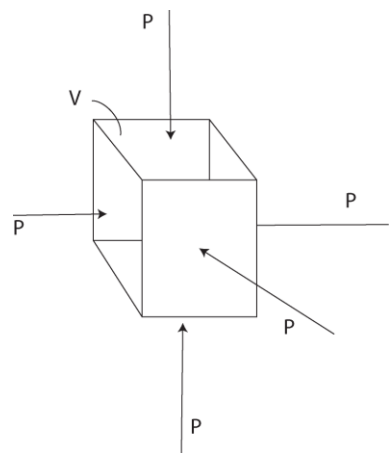

Squeezing a 3D volume V

V to V + ΔV

Stress = P

Strain = - ΔV/V

BULK Modulus $B = \dfrac{P}{-\Delta V / V}$

SHEAR

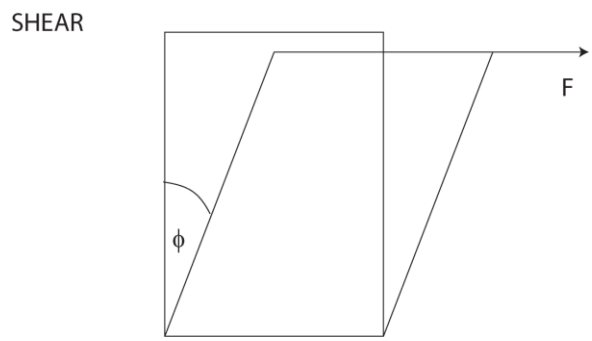

SHEAR

Shear Modulus $B = \dfrac{F / A}{\Phi}$

Pressure at depth h in fluid

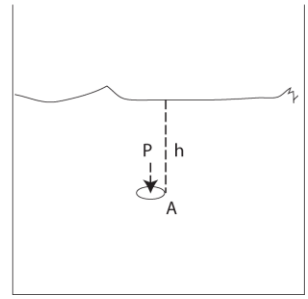

$P = \rho gh$

ρ = density of fluid

Motion of fluids in pipes

Conservation of mass (fluid incompressible) and conservation of energy

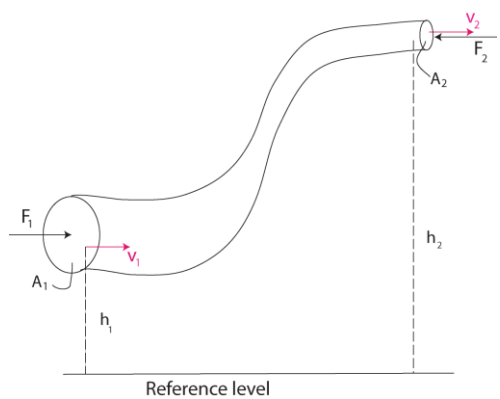

$$\frac{1}{2}\rho v_1^2 + \rho g h_1 + P_1 = \frac{1}{2}\rho v_2^2 + \rho g h_2 + P_2$$

(Bernouillis's eq'n)

At point 1 height h1 above reference level

V_1 is velocity and P_1 is pressure

Buoyancy

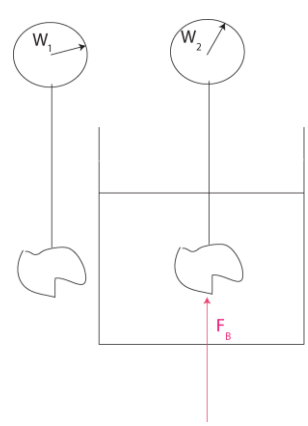

Archimede's Principle

F_B = weight of fluid displaced = $W_1 - W_2$

PHY 2004

Lectures 16-20

MOMENTUM

Collision

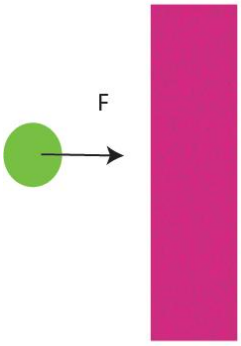

Impulse $I = F\,t$

$F = ma = m(V_f - V_I)/t$

Hence:

$I = mV_f - mV_i$

Momentum $P = mV$

NO impulse, no force, no collision

NO CHANGE IN MOMENTUM

called conservation of momentum

Example:

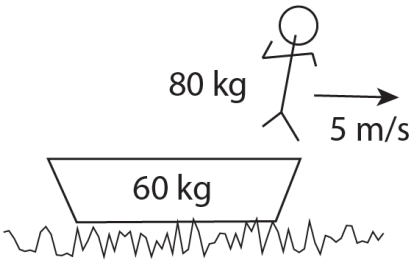

You jump off a boat

Before jump P=0

Therefore, after jump P=0

$\mathbf{P_{after} = P_{Man} + P_{boat}}$

Therefore $\mathbf{P_{boat} = -P_{man} = -400 = M_{boat}V_{boat} = 60\ V_{boat}}$

THUS $\mathbf{V_{boat} = -6.7}$ m/s (minus sign means goes backward)

ELASTIC COLLISIONS

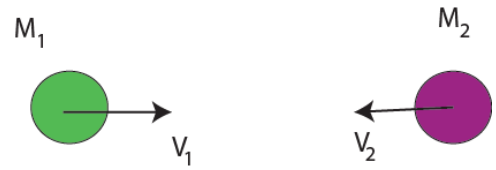

Momentum initial = Momentum after

$$M_1V_1^{Init} + M_2V_2^{Init} = M_1V_1^{after} + M_2V_2^{after}$$

No energy losses, therefore

$$(1/2)M_1(V_1^{Init})^2 + (1/2)M_2(V_2^{Init})2 = (1/2)M_1(V_1^{after})^2 + (1/2)M_2(V_2^{after})^2$$

USE both equations can show;

$$V_1^{Init} + V_1^{after} = V_2^{Init} + V_2^{after}$$

USED often

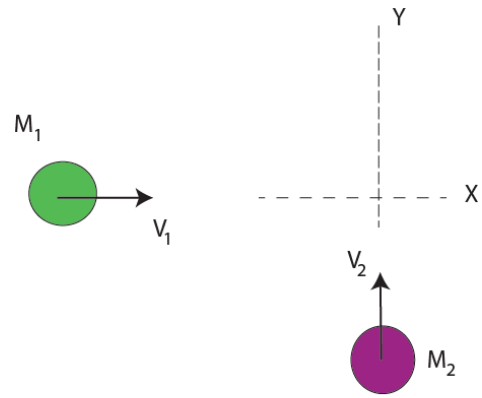

Collisions in TWO Dimensions

Separate momentum into components in X and Y direction

P total in X direction is constant

AND

P total in Y direction is constant

Chapter 9

ANGULAR MEASUREMENTS

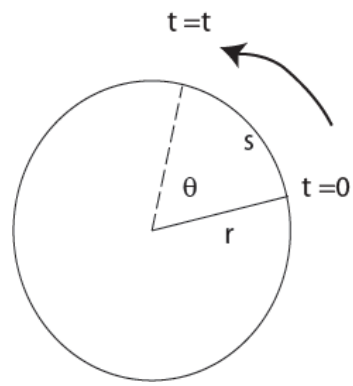

In time t

sweep out θ

$$\theta = s/r$$

θ is in RADIANS

1 Revolution = 360 degrees =2π radians

ANGULAR VELOCITY

ω = θ/t radians / sec.

TANGENTIAL VELOCITY

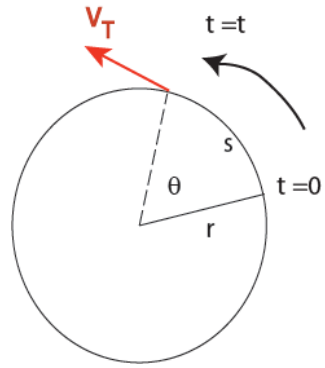

$V_T = r\omega$

r must be in radians /sec.

V_T is in m/s if r is in meters

CENTRIPETAL ACCELERATION

Tangential velocity is CONSTANT in magnitude

BUT <u>direction changes</u> by ΔV

THEREFORE there is an

acceleration toward the center

$a_C = V_T^2/r$

PLANETS

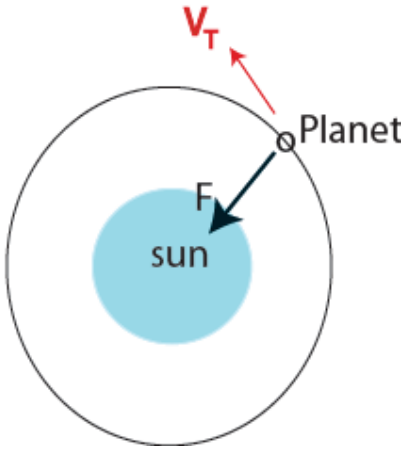

Constant angular speed (approximately)

Centripetal acceleration = V_T^2/r

Provided by gravitational force

$F=GMm/r^2$

HENCE

$V_T = \sqrt{(GM/r)}$

PHY 2004 LECTURES 10-12

EQUILIBRIUM Chapter 8.

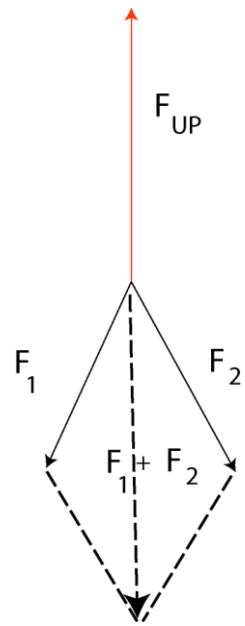

No motion (OR constant motion i.e. no acceleration)

Vector sum of forces =0

I.e. in figure to right $F_1 + F_2 = F_{UP}$

In figure below,

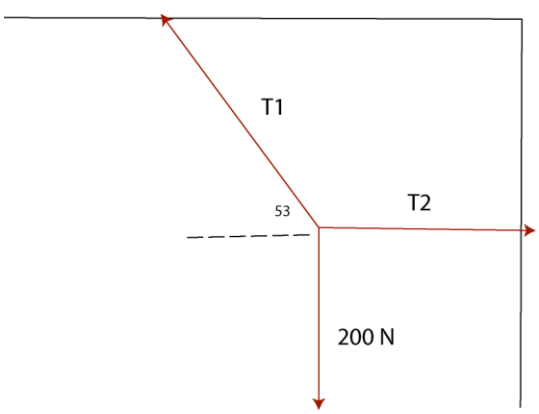

Equilibrium requires

For horizontal direction;

$T1 = T2 \cos 53 = 0.6T2$

For vertical direction;

$T2 \sin 53 = 2\ 00$, OR $0.8T2 = 200$

Solve T1= 150 N

Turning effect

Measure of turning or twisting (rotational or angular) motion

Torques must cancel

Torque

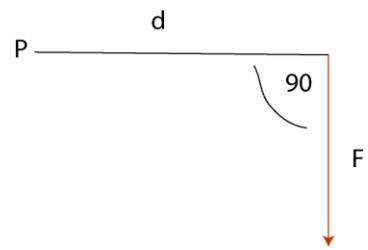

τ = d * perpendicular component of force to axis d

= dF

Has a sense of rotation about P: clockwise (+) or anticlockwise (-)

Equilibrium:

Sum of all torques about ANY point in system must =0

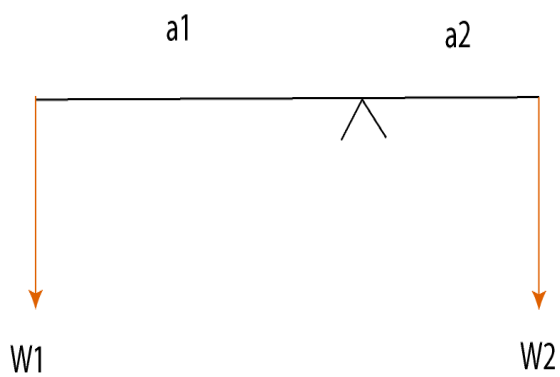

E.g seesaw

Sum of torques =0

W1 *a1 +W2*a2 =0

PHY 2004, Lectures 8-9

ENERGY, WORK

Work

$W = FxD.$

D =distance in the same direction as the force

Work by gravity

F=mg If move against gravity do positive work

W =mgh

This energy is stored, e.g placing a mass on a shelf at height h

Can recover this POTENTIAL energy

Knock mass off shelf. Object gains KINETIC energy

Use $V_F^2 = 2gh$

to show final kinetic energy $K =(1/2)mV^2$

LECTURE 7 PHY 2004

FRICTION

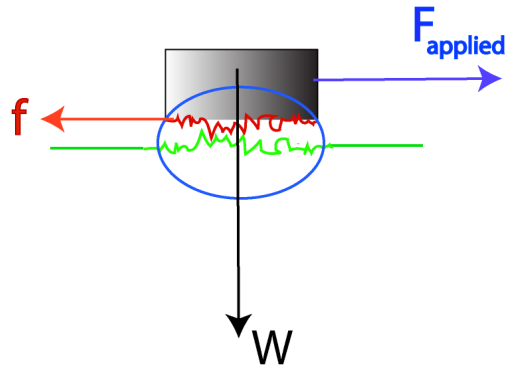

Force of friction proportional to force NORMAL to motion

μ = coefficient of friction $f=\mu W$

Rubber on concrete	**$\mu \approx 0.8$**
Steel on steel	**0.07**
Skater on ice	**0.02**

Static versus sliding friction

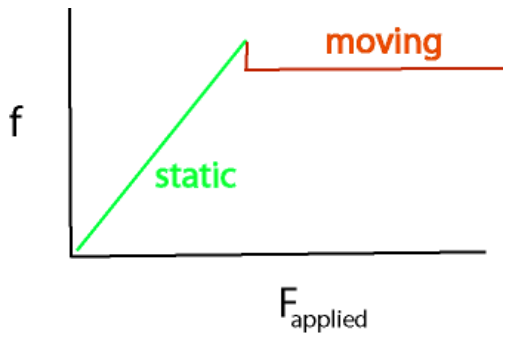

Object does not move until

$F_{applied}$ overcomes static friction

Inclined plane

Force normal to plane

$F = W\cos\theta$

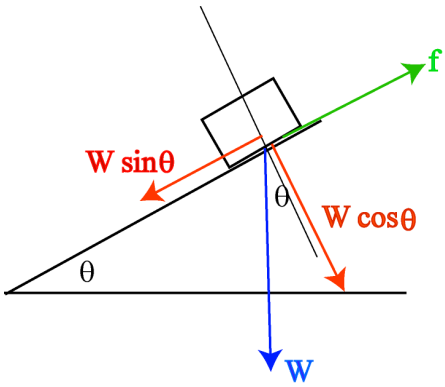

Friction $f = \mu W\cos\theta$

SLIDES when $W\sin\theta = f$

OR $\tan\theta = \mu$

LECTURE 6 PHY 2004

Gravity

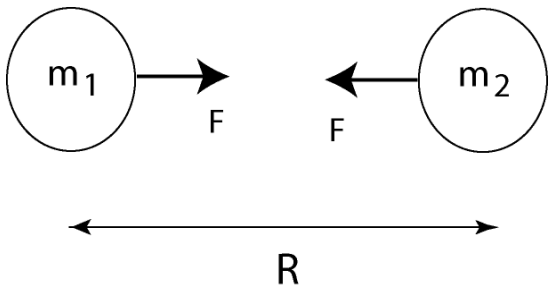

Force

$$F = \frac{Gm_1m_2}{R^2}$$

G is universal constant

(same everywhere)

Weight

$$F = m_1 g = \frac{G m_1 m_2}{R^2}$$

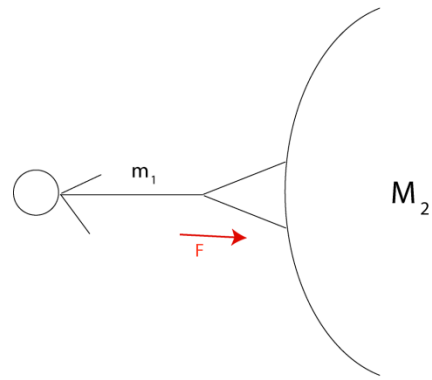

Thus

$$g = \frac{G m_2}{R^2}$$ **for mass on surface of planet M_2**

Problem 3.41

g(moon) =1.6m/s2

Weight on moon = 1.6(4) = 6.4 N

Weight on Earth = 9.8(4) 39.2 N

LECTURE 5 PHY 2004

Chap. 2 #43

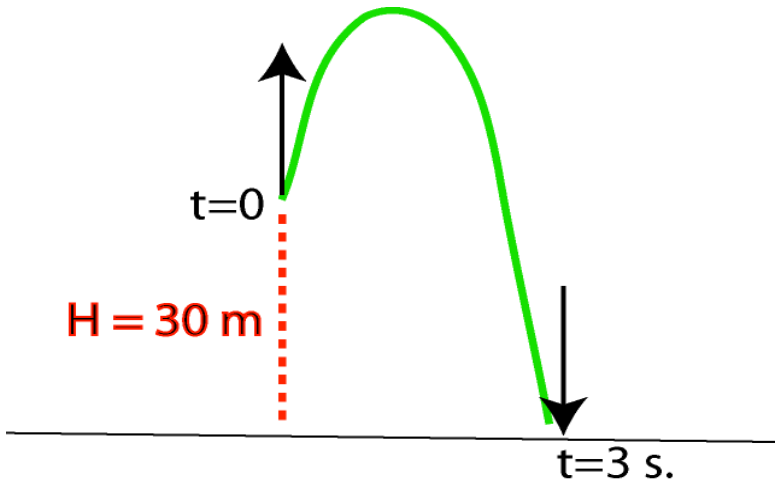

$Y = V_i t + (1/2)at^2$ ..... (1)

At end Y = -30 m (below origin)

acceleration a = -g= -9.8m/s2

Put in Eq'n (1)

$-30 = V_i\, 3 - (1/2)(9.8)\, 9$

$V_i = (4.9)3 = 4.7$ m/s

Chap 2. # 35

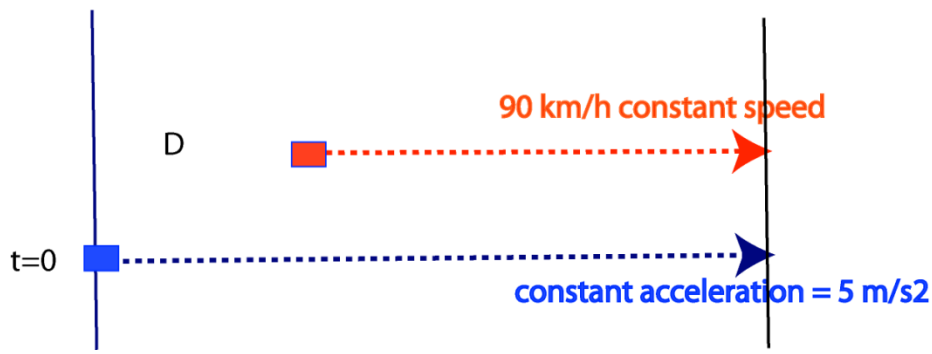

Red speed constant = 90 km/h = 25 m/s

Blue does not start until 5 seconds after red passes, D=(5)(250)=125 m

Need to find t, then calculate distances

NOTE: $X_{blue} = X_{red} + 125$ …….Eq'n (1)

$X_{red} = 25\ t$

$X_{blue} = (1/2)\ at^2 = (1/2)5t^2 = 2.5t^2$

Use Eq'n (1)

$2.5\ t^2 = 25t + 125$, or

$t^2 = 10t + 50$,

or $t=5 \pm\sqrt{(75)}$ (-ve sign non-physical)=5 +8.7 = 13.7s

$X_{red} = 25\ t = 341.5$ m

$X_{blue} = 466.5$ m

LECTURE 3 PHY 2004

Gravity constant at Earth's surface (always "down")

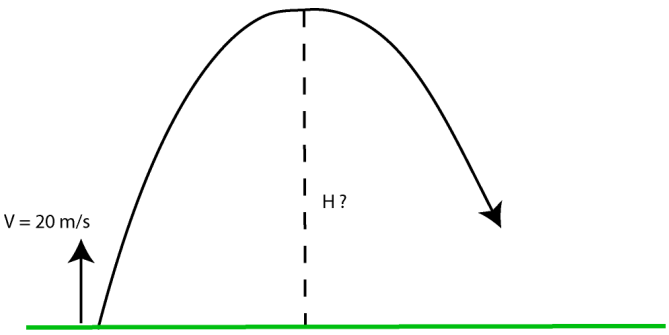

Typical problem

Throw ball up at 20 m/s. How high will it go?

$V_F^2 = V_i^2 + 2aH$

a = - 9.8 m/s^2 (gravity DOWN deceleration)

$V_F = 0$

$0 = 202 - 2(9.8)H$

$H = 400/19.6 = 20.4$ m

Projectile Motion

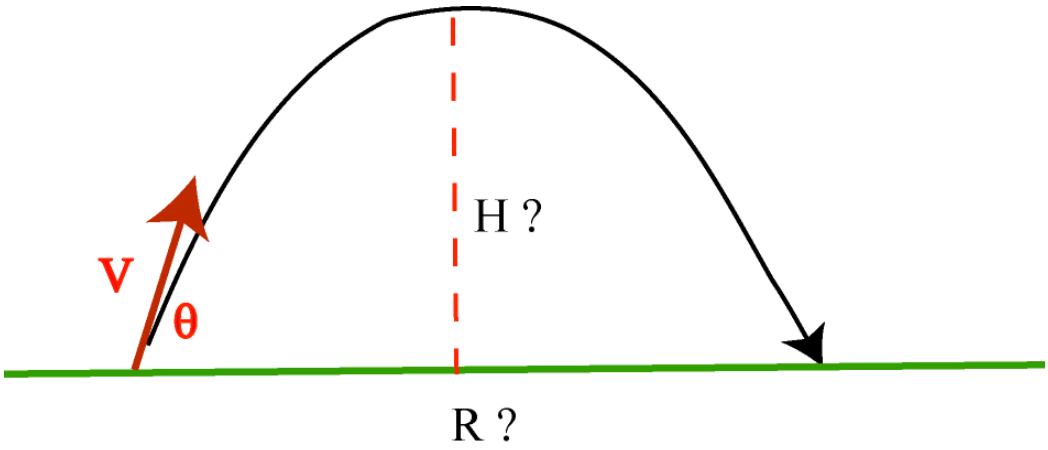

Initial velocity V at angle θ to horizontal

Calculate R

Calculate θ

_____

LECTURE 4 PHY 2004

Continuing the above problem from lecture 3.

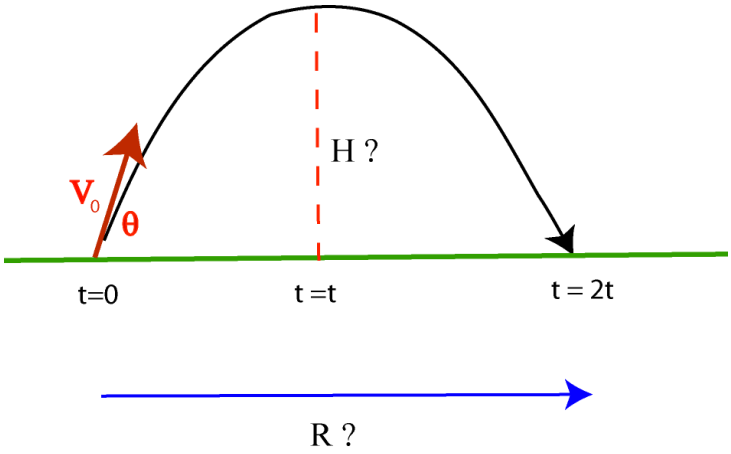

Key point to remember, the x and y motions are independent.

Resolve V into x and y motions

$V_X = V_0 \cos\theta$

$V_Y = V_0 \sin\theta$

Consider vertical motion. V_y =0 at top where y =H

V_{avg} **(y-direction) = (1/2) $V_0 \sin\theta$**

At top use $V_F = V_i + at$, or $0 = V_0\sin\theta - gt$ which gives $t = (V_0\sin\theta)/g$

$H = V_{avg}.t = (1/2)V_0 \sin\theta.(V_0\sin\theta/g)$ **No need to memorize this formulae,**

just remember simple red equations

R= (total time) $V_x = 2t\, V_0\cos\theta$

PHY 2004: *Applied Physics in our world today*

Neil S. Sullivan ***Fall 2010***

NPB Rm 2235

Email: sullivan@phys.ufl.edu

Tel. 352-846-3137

Class meets: M W F (Period 8) 3:00 -3:50 PM

NPB 1001

Office Hours: M W F (Period 4) 10:40 – 11:30 AM

NPB 2235

Textbook:



Technical Physics

F. Bueche & D. Wallach

(4th ed., J. Wiley & Sons, 1994)

PHY 2004

GENERAL POINTS

Reference materials, important dates: **CHECK** **course web site**

Course Goals

General introduction to use of physics in **everyday life**

Simple applications, useful in professional careers

Emphasis on principles (not lengthy calculations)

Exams:

Some problems in exams will be from problems

discussed in class and in in-class quizzes (clicker responses)

Make-up exams (date TBD) Need SIGNED documentation

from Dr. coach teacher etc.

HITT:

Have remotes by September 7 (to have in-class quizzes recorded)

PHY 2004 Exams Fall 2010

All here in NPB 1001

Mid-term: Best two 30 points each

1. **Sept. 20 Pd 8 (3-3:50 PM)**
2. **Oct. 20 Pd 8 (3-3:50 PM)**
3. **Nov. 19 Pd 8 (3-3:50 PM)**
4.

Final Dec. 13 (3-5 PM) 40 points

unless third midterm better than final in which case

final =30 points and other mid-term=10 points)

In class questions = bonus of 5 %

LECTURE 2 PHY 2004

MOTION

Speed (scalar) distance per unit time meters/sec

Velocity (vector) speed + direction

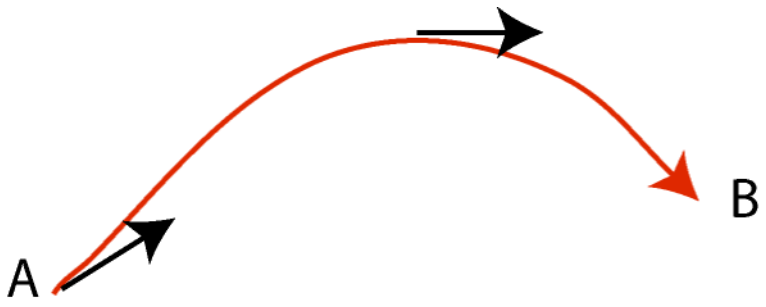

Direction different at different points

Average velocity = displacement vector AB/time

Acceleration (vector)

Rate of change of velocity

$a = (V_F - V_I)/t$ OR $V_F = V_I + at$

Uniform acceleration (typical in this class)

e.g. gravity, rockets

$X = V_{avg}\, t$ where V_{avg} is average velocity $V_{avg} = (V_I + V_F)/2$

THUS $X = (V_F^2 - V_I^2/2a)$ OR $V_F^2 = V_I^2 + 2aX$

ALSO $X = V_{avg}\, t$ OR $X = V_I t + (1/2)at^2$

LECTURE 3 PHY 2004

Gravity constant at Earth's surface (always "down")

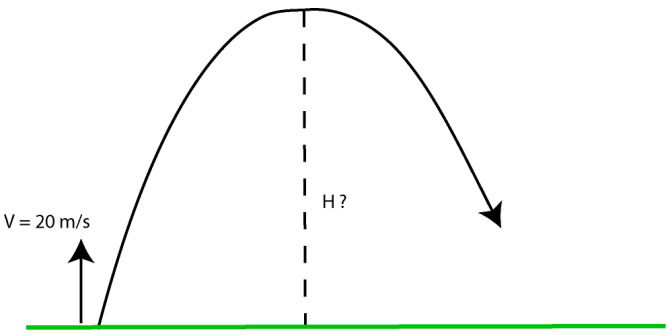

Typical problem

Throw ball up at 20 m/s. How high will it go?

$V_F^2 = V_i^2 + 2aH$

a = - 9.8 m/s^2 (gravity DOWN deceleration)

$V_F = 0$

$0 = 202 - 2(9.8)H$

$H = 400/19.6 = 20.4$ m

Projectile Motion

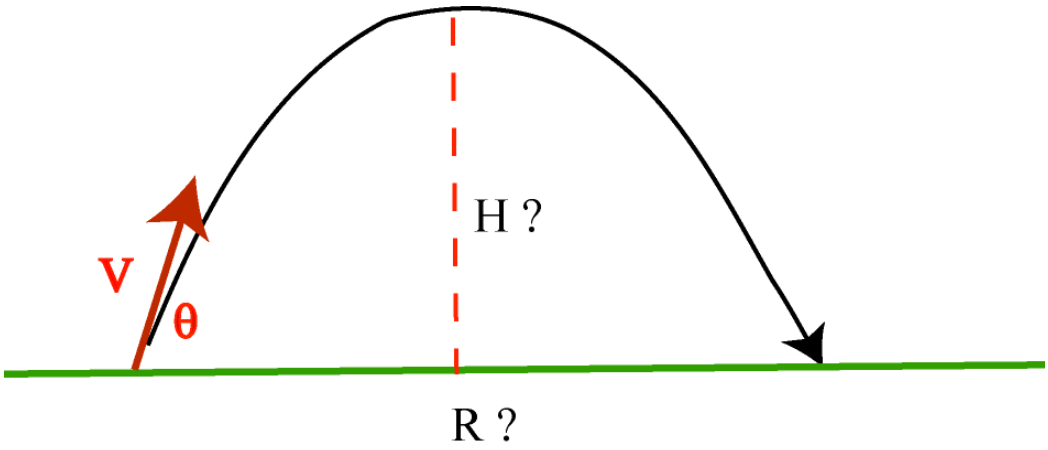

Initial velocity V at angle θ to horizontal

Calculate R

Calculate θ

_____

LECTURE 4 PHY 2004

Continuing the above problem from lecture 3.

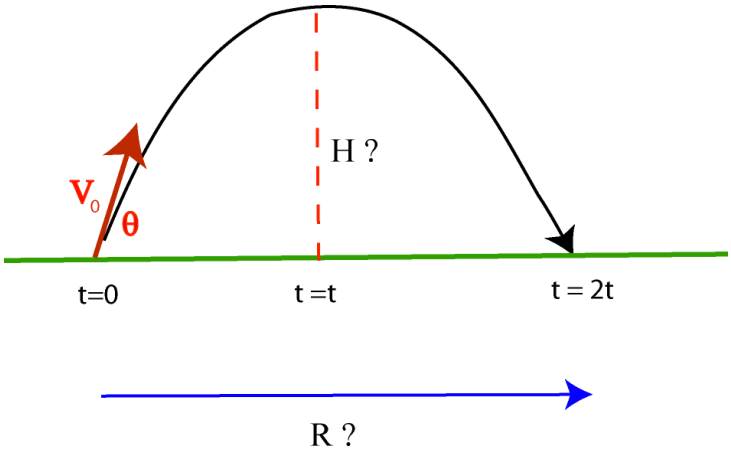

Key point to remember, the x and y motions are independent.

Resolve V into x and y motions

$V_X = V_0 \cos\theta$

$V_Y = V_0 \sin\theta$

Consider vertical motion. V_y =0 at top where y =H

V_{avg} **(y-direction) = (1/2) $V_0 \sin\theta$**

At top use $V_F = V_i + at$, or $0 = V_0\sin\theta - gt$ which gives $t = (V_0\sin\theta)/g$

$H = V_{avg}.t = (1/2)V_0 \sin\theta.(V_0\sin\theta/g)$ **No need to memorize this formulae,**

just remember simple red equations

R= (total time) $V_x = 2t\, V_0\cos\theta$